組合せとグラフの理論　(塩田)

2012 年 7 月 13 日の宿題

学籍番号　　氏名

問題　以下のグラフは全て完全マッチングを持つ。それぞれ完全マッチングをひとつ図に描き入れよ。（できれば色つきで）

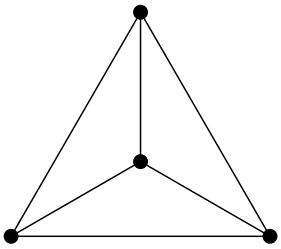

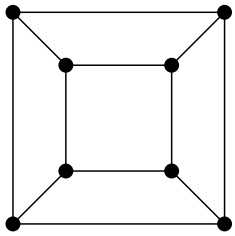

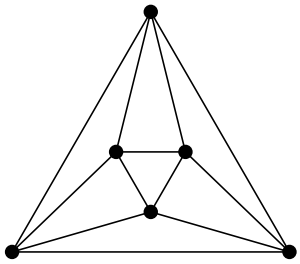

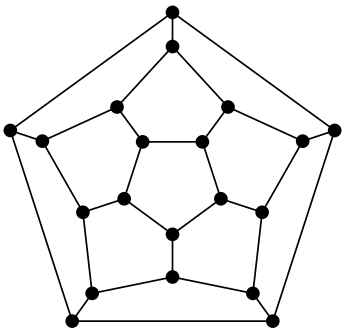

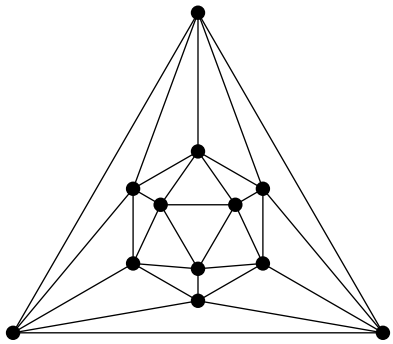

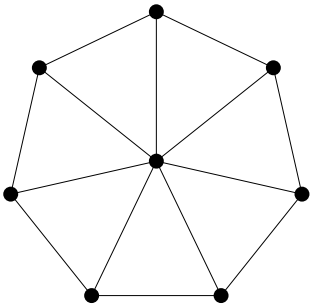

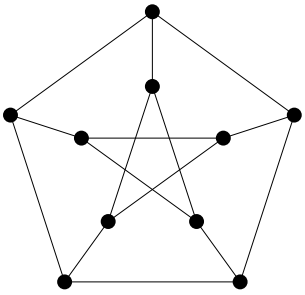

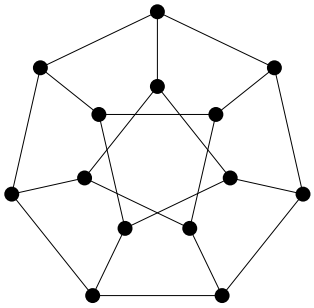

提出期限：7 月 20 日　(試験時、または情報科学棟 512 号室ポストまで)